VERTEIDIGEN

Eine Figur von Weiß ist angegriffen. Kreise diese ein!
Verteidige diese. Zeige die Lösung durch einen Pfeil an.

1



1.Tb6

2



1.Se2

3



1.Sc3

4



1.Dc2

5



1.Txa6

6



1.Lf1